Measurement

LENGTH

CLASS-I

06.10.20



See the objects carefully & tell which is having more length?





Measure each object using blocks.

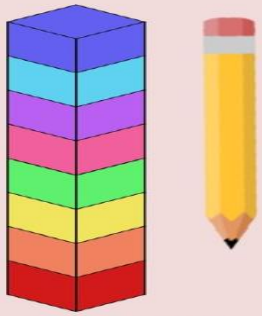

Blocks

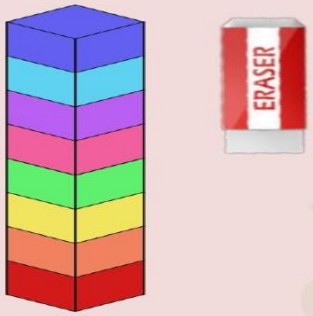

Blocks

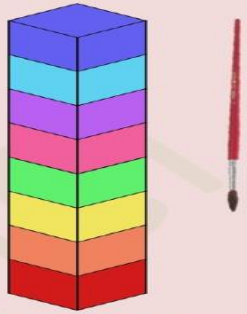

Blocks

Blocks

Blocks

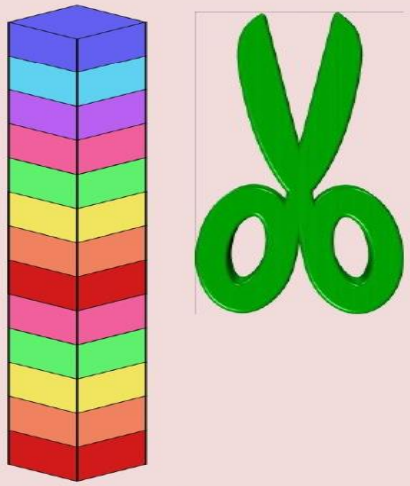

Blocks

7

4

8

6

6

10

Write 1 to 3 to show the order from shortest to longest object.

1)

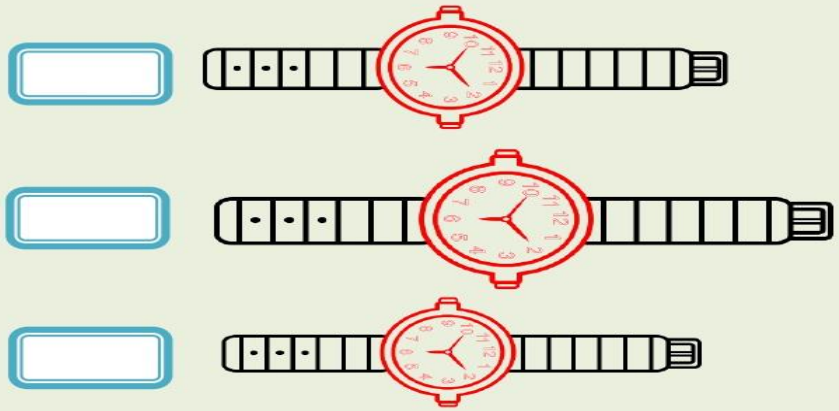

2)



3)

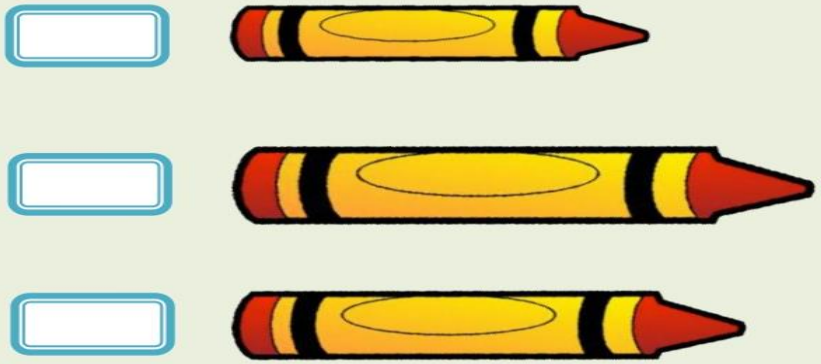

4)



1
2
3

1
2
3

1
3
2

1
2
3

Compare the following animals in terms of height and answer the questions.



1. Who is the shortest? _____
2. Who is the tallest? _____
3. Giraffe is _____ than Tiger.
4. Cat is _____ than Elephant.
5. Tiger is _____ than Dog.
6. Elephant is _____ than Giraffe.
7. Dog is _____ than Cat.
8. Cat is _____ than Tiger.

taller

taller

shorter

taller

shorter

Mouse

shorter

taller

giraffe

Well Done !