DAV POLICE PUBLIC SCHOOL, PANCHKULA

Class: I **Subject- MATHS**

Assignment- Count & Write

These objects have been put into groups of 10. Help Newton to count them.

1) How many?

2) How many?



3) How many?



4) How many?



5) How many?


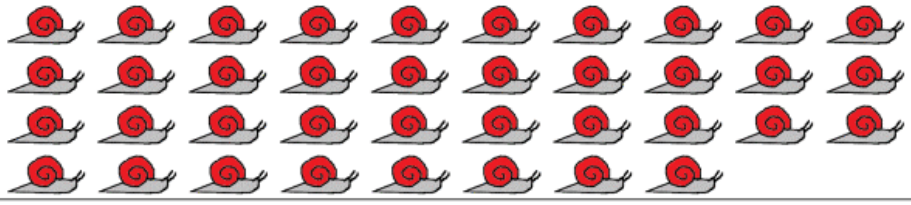
6) How many?